Ordering sets from least to greatest and greatest to least

WORKSHEET#6

Determine the number of objects in each box and arrange the following numbers from greatest to least.



____ ____ ____ ____

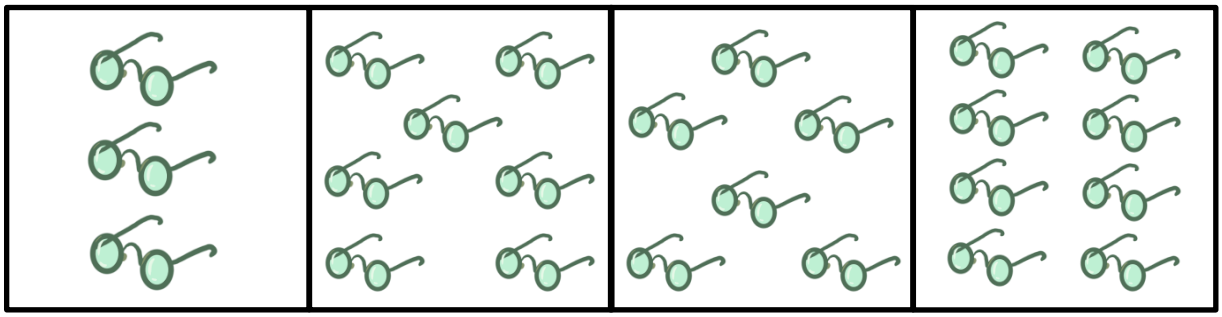

____ ____ ____ ____



____ ____ ____ ____



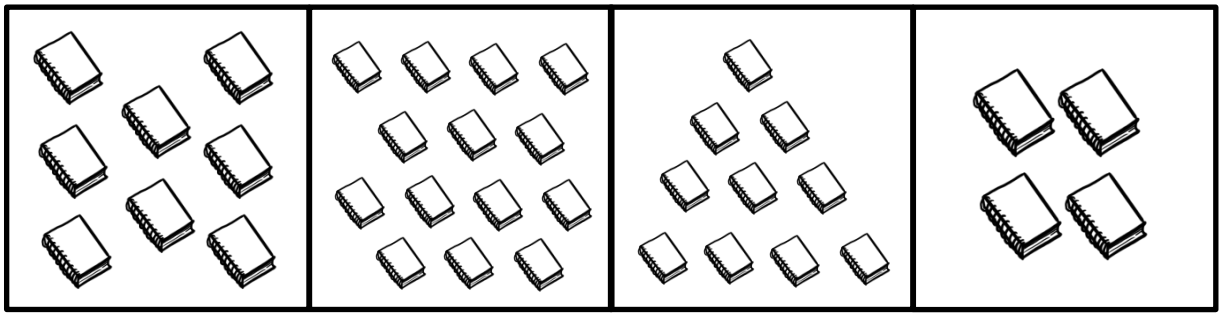



ANSWERS

RIBBONS	-	4, 9, 3, 5	-	9, 5, 4, 3
GLASSES	-	3, 7, 6, 8	-	8, 7, 6, 3
TEACUPS	-	8, 5, 9, 2	-	9, 8, 5, 2
STRAWBERRIES	-	12, 20, 5, 9	-	20, 12, 9, 5
BOOKS	-	8, 14, 10, 4	-	14, 10, 8, 4
HATS	-	4, 12, 9, 7	-	12, 9, 7, 4