Finding Perimeters

WORKSHEET#6

Calculate the **perimeter** of following Shapes.

(The measurements are not according to the scale.)

1.

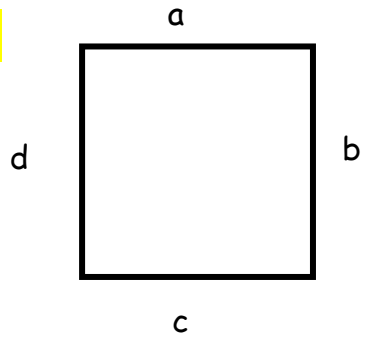

a = 5 cm

b = 5 cm

c = 5 cm

d = 5 cm

Perimeter =

2.

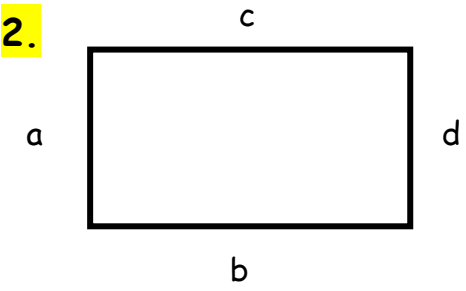

a = 3 cm

b = 6 cm

c = 6 cm

d = 3 cm

Perimeter =

3.

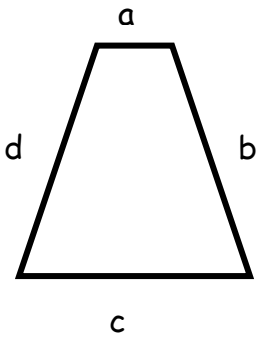

a = 1 cm

b = 4 cm

c = 3 cm

d = 4 cm

Perimeter =

4.

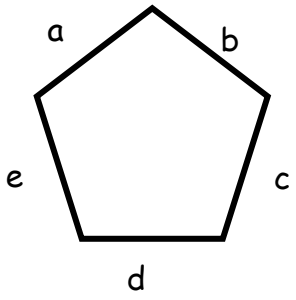

a = 2 cm

b = 2 cm

c = 2 cm

d = 2 cm

e = 2 cm

Perimeter =

ANSWERS

1) 20 cm

2) 18 cm

3) 12 cm

4) 10 cm