Finding Perimeters

WORKSHEET#5

Calculate the **perimeter** of following Shapes.

(The measurements are not according to the scale.)

1.

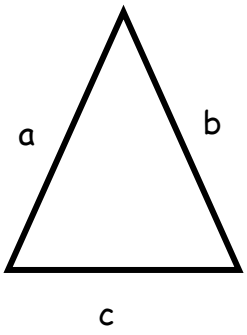

a = 7 cm

b = 7 cm

c = 5 cm

Perimeter =

2.

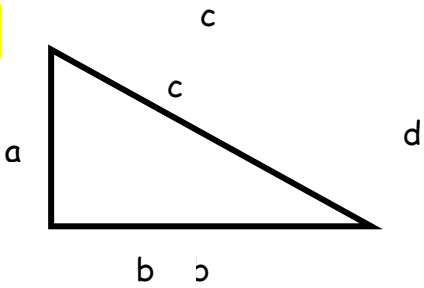

a = 3 cm

b = 4 cm

c = 5 cm

Perimeter =

3.

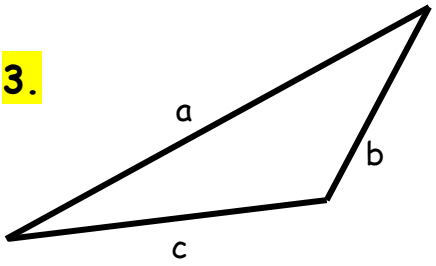

a = 9 cm

b = 5 cm

c = 6 cm

Perimeter =

4.

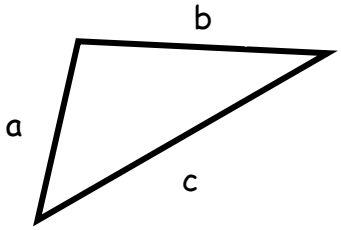

a = 2 cm

b = 3 cm

c = 4 cm

Perimeter =

ANSWERS

1) 19 cm

2) 12 cm

3) 20 cm

4) 9 cm